Name: _____ Date: _____

Measuring and Classifying Angles

Year 6 – Geometry



Use a protractor to measure the size of each angle.
Then classify it as acute, obtuse, right or reflex.

- **Acute**: less than 90°
- **Obtuse**: greater than 90° but less than 180°
- **Right**: exactly 90°
- **Reflex**: greater than 180° but less than 360°

1. Measure and classify each angle.

1)

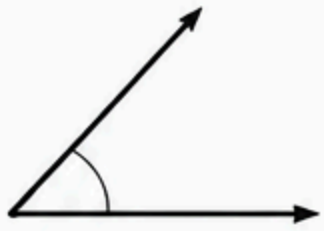

Angle size: _____

Type: _____

2)

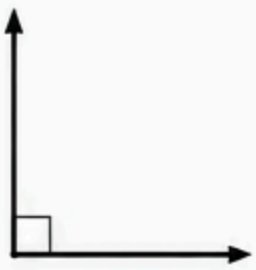

Angle size: _____

Type: _____

3)



Angle size: _____

Type: _____

4)

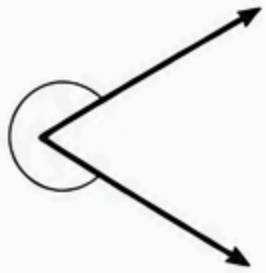

Angle size: _____

Type: _____

5)



Angle size: _____

Type: _____

6)

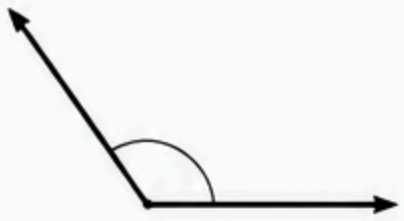

Angle size: _____

Type: _____

7)

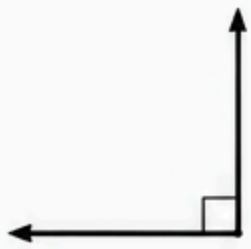

Angle size: _____

Type: _____

8)

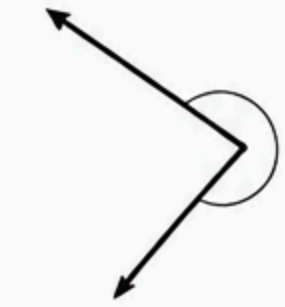

Angle size: _____

Type: _____

2. Classify the angles below. Write the correct type in each box.

1)

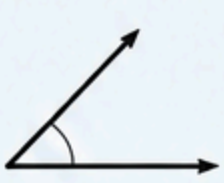

2)

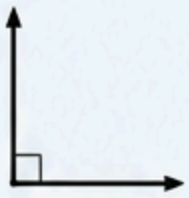

3)

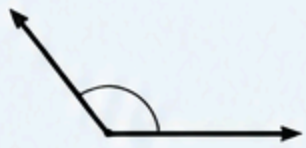

4)



5)

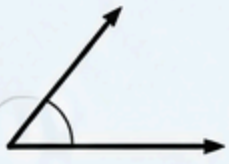

6)



7)



8)

