Name: _____ Date: _____

Reading Scales and Measuring Instruments

Read the scales and answer the questions.

1 Rulers

Look at the rulers below. Write the length of each object in centimetres (cm).

a)

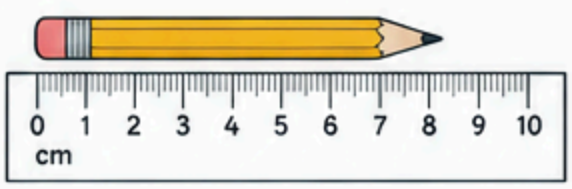

Length = _____ cm

b)

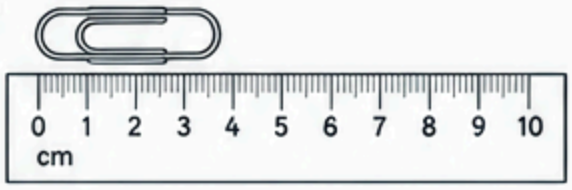

Length = _____ cm

c)

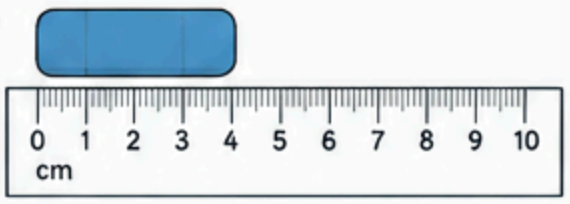

Length = _____ cm

2 Weighing scales

Look at the scales below. Write the weight of each item in kilograms (kg) and grams (g).

a)

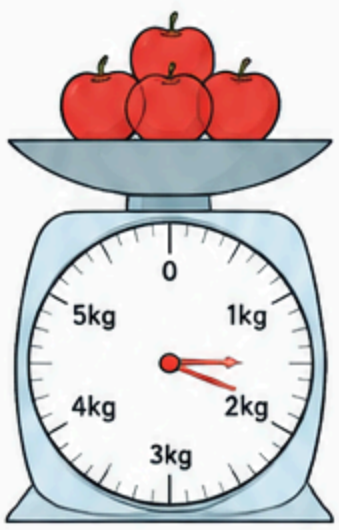

Weight = _____ kg _____ g

b)



Weight = _____ kg _____ g

c)



Weight = _____ kg _____ g

3 Measuring jugs

Look at the measuring jugs below. Write the amount of liquid in each jug in millilitres (ml).

a)



Amount = _____ ml

b)



Amount = _____ ml

c)



Amount = _____ ml

4 Thermometers

Look at the thermometers below. Write the temperature in degrees Celsius (°C).

a)



Temperature = _____ °C

b)



Temperature = _____ °C

c)

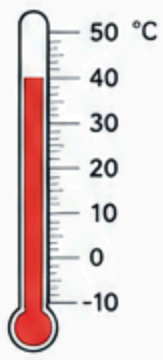

Temperature = _____ °C

d)



Temperature = _____ °C