Name: _____ Date: _____

Reading Scales and Measuring Instruments

Year 6 – Measurement

1. Rulers

Read the length of each object. Give your answer in centimetres (cm).

a)



_____ cm

b)

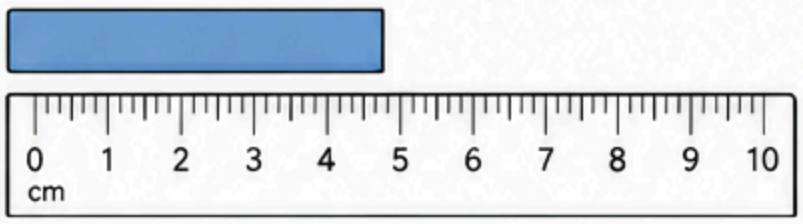

_____ cm

c)



_____ cm

2. Thermometers

Read the temperature shown on each thermometer.
Give your answer in degrees Celsius (°C).

a)

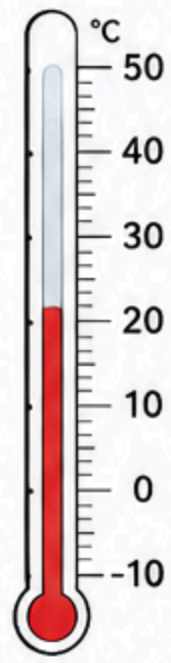

_____ °C

b)



_____ °C

3. Weighing Scales

Read the mass of each item. Give your answer in grams (g).

a)



_____ g

b)

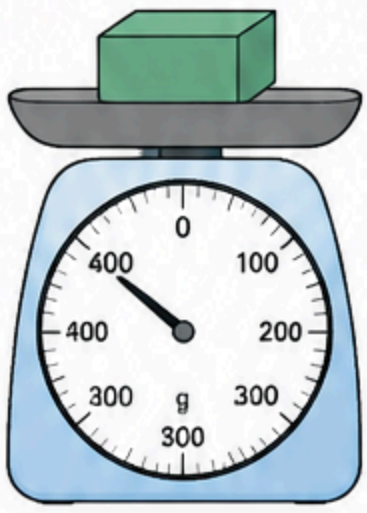

_____ g

4. Measuring Jugs

Read the volume of liquid in each jug.
Give your answer in millilitres (ml).

a)

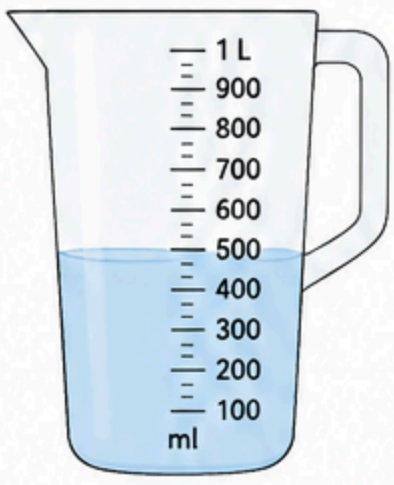

_____ ml

b)

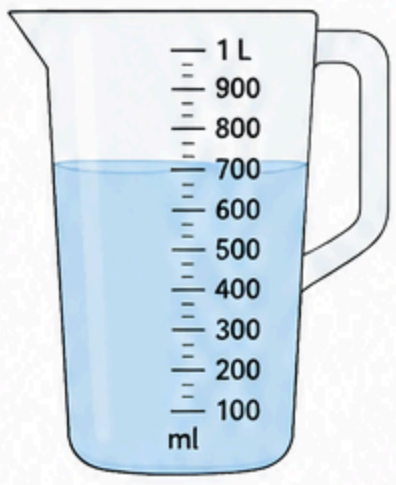

_____ ml

5. Speedometers

Read the speed shown on each speedometer. Give your answer in kilometres per hour (km/h).

a)



_____ km/h

b)



_____ km/h