Financial Maths – Year 5

# Reading Scales and Measuring Money

**Name:** _____ **Date:** _____

## 1. Read the number lines

Look at each number line. Write the amount shown by the arrow.

a)




£_____

b)

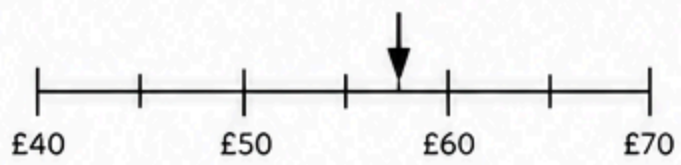


£_____

c)

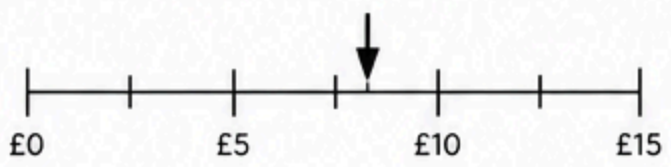


£_____

## 2. Read the scales

Look at each scale. Write the amount shown by the pointer.

a)




£_____

b)

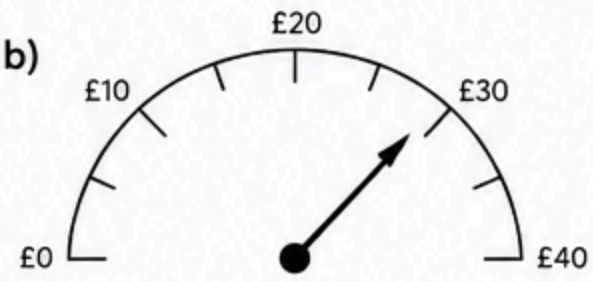


£_____

c)




£_____

## 3. Find the intervals

Work out the difference between the two amounts shown on each number line or scale.

a)

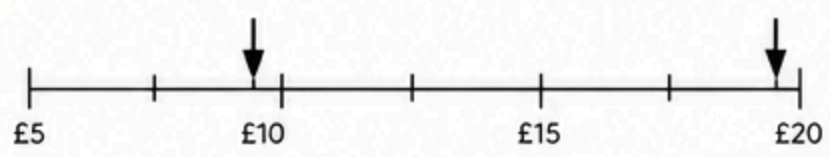


Interval: £_____

b)

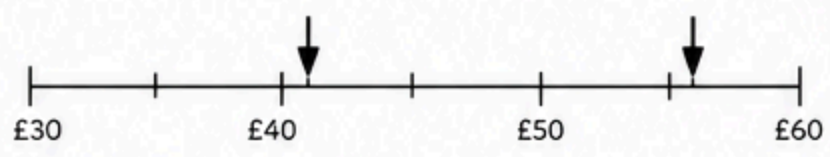


Interval: £_____

c)

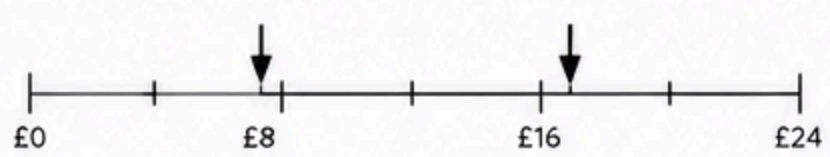


Interval: £_____

## 4. Use the scales

Read the scales and answer the questions.

a) How much is shown on the scale?




£_____

b) What is the difference between £12 and £36?

£_____

c) The amount is £27. How far is it from £15?

£_____

## 5. Read the money scales

Look at each set of coins or scale. Write the amount shown.

a)




Amount: £_____

b)




Amount: £_____

c)

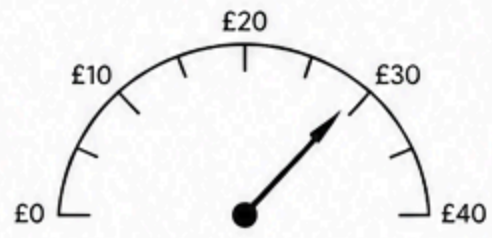


Amount: £_____