Name: _____ Date: _____

Picture Multiplication Arrays

Count the objects in each array. Write the number of rows and columns, then write the multiplication fact.

1.

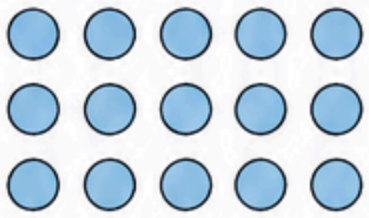

Rows: _____

Columns: _____

Multiplication fact: _____

2.



Rows: _____

Columns: _____

Multiplication fact: _____

3.



Rows: _____

Columns: _____

Multiplication fact: _____

4.



Rows: _____

Columns: _____

Multiplication fact: _____

5.



Rows: _____

Columns: _____

Multiplication fact: _____

6.



Rows: _____

Columns: _____

Multiplication fact: _____

7.



Rows: _____

Columns: _____

Multiplication fact: _____

8.



Rows: _____

Columns: _____

Multiplication fact: _____

9.



Rows: _____

Columns: _____

Multiplication fact: _____

10.



Rows: _____

Columns: _____

Multiplication fact: _____

11.



Rows: _____

Columns: _____

Multiplication fact: _____

12.



Rows: _____

Columns: _____

Multiplication fact: _____