Name: _____ Date: _____

Reading Scales on Money Thermometers

Look at each money thermometer. Write the amount shown by the arrow.
Use £ and p (pence).

1.



The amount is £_____

2.



The amount is £_____

3.

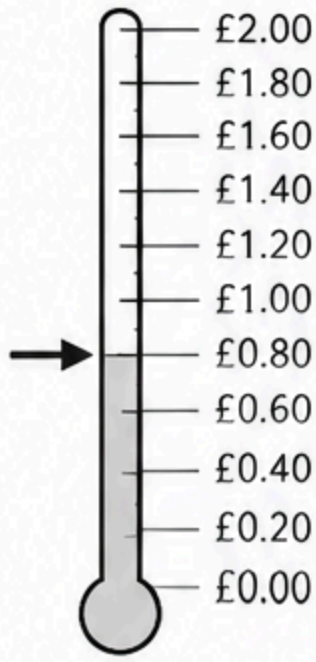

The amount is £_____

4.



The amount is £_____

5.



The amount is £_____

6.

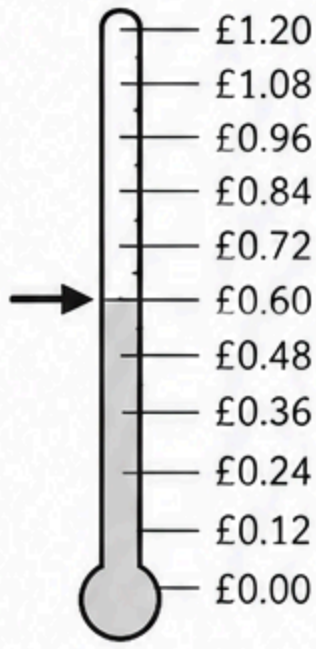

The amount is £_____

7.



The amount is £_____

8.

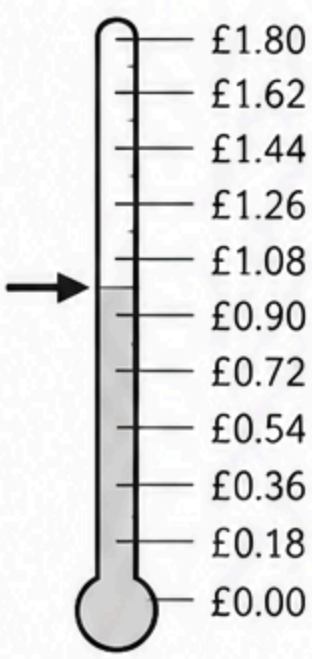

The amount is £_____

9.

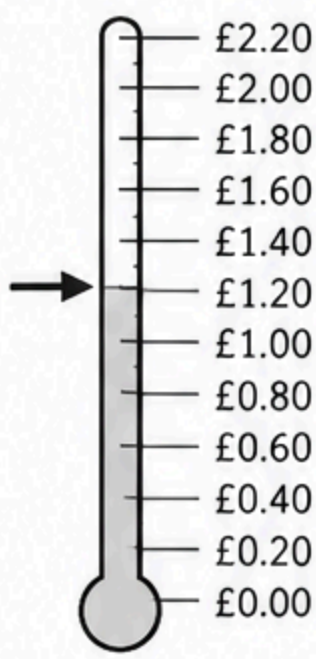

The amount is £_____