Name: _____ Date: _____

Shade Fractions of Shapes and Grids

Year 8 – Fractions

Shade the given fraction of each shape or grid. Make sure the parts are equal.

1. Rectangular grids

Shade the fraction of each grid.

a) $\frac{3}{8}$

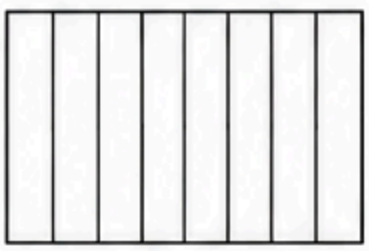

b) $\frac{5}{12}$



c) $\frac{2}{5}$

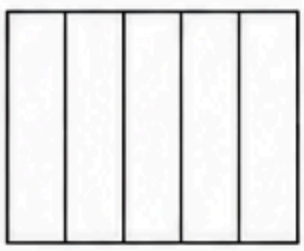

d) $\frac{7}{10}$



2. Circles

Shade the fraction of each circle. The circles are divided into equal parts.

a) $\frac{1}{4}$



b) $\frac{3}{8}$

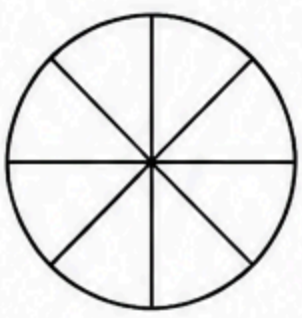

c) $\frac{5}{6}$

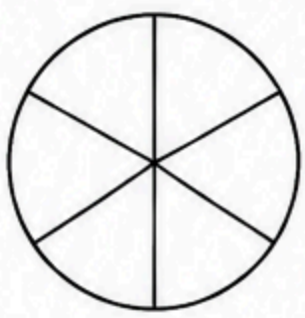

d) $\frac{7}{12}$

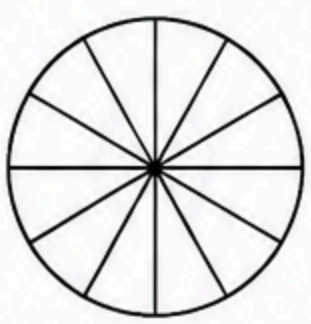

3. Other shapes

Shade the fraction of each shape. The parts are equal.

a) $\frac{1}{3}$

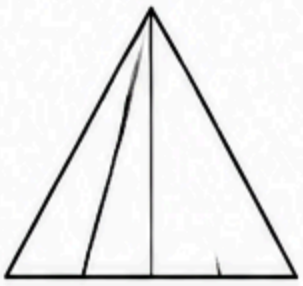

b) $\frac{4}{6}$



c) $\frac{2}{9}$

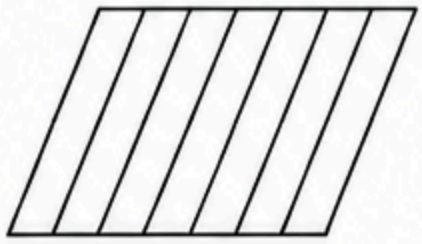

d) $\frac{3}{5}$

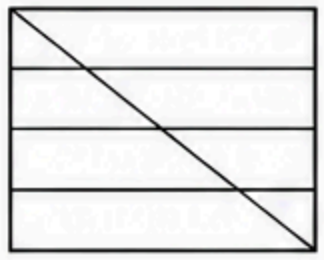

4. Mixed practice

Shade the fraction of each shape or grid.

a) $\frac{5}{8}$

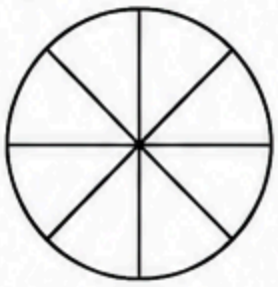

b) $\frac{1}{2}$

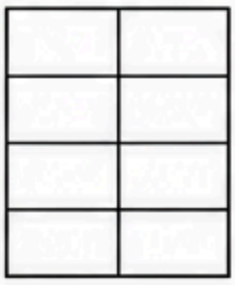

c) $\frac{3}{4}$

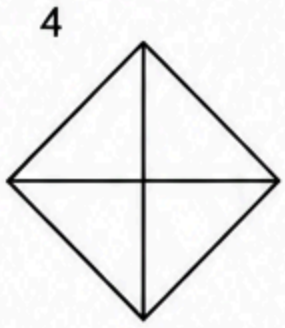

d) $\frac{2}{7}$

