MEASUREMENT • YEAR 7

# Calculating Perimeter of 2D Shapes

Name _____ Date _____

Add the lengths of all the outside sides. Convert lengths to the same unit before adding. Show your working and include the correct unit in each answer.

## 1 Rectangles

Find each perimeter.

### 1 Rectangle




Find the perimeter in centimetres.

**P = _____ cm**

Working:

### 2 Rectangle




Find the perimeter in metres.

**P = _____ m**

Working:

### 3 Rectangle




Find the perimeter in centimetres.

**P = _____ cm**

Working:

## 2 Triangles

Add all three side lengths.

### 4 Triangle

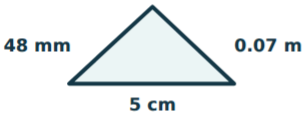


Find the perimeter in centimetres.

**P = _____ cm**

Working:

### 5 Triangle

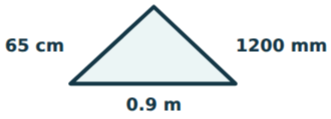


Find the perimeter in metres.

**P = _____ m**

Working:

### 6 Triangle




Find the perimeter in millimetres.

**P = _____ mm**

Working:

## 3 Compound shapes

Use the outside edges only.

### 7 L-shape

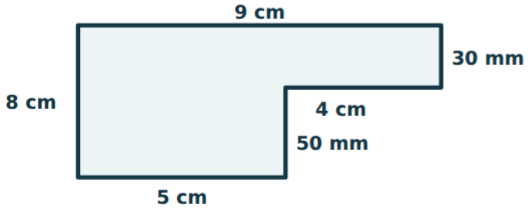


Find the perimeter in centimetres.

**P = _____ cm**

Working:

### 8 Stepped shape

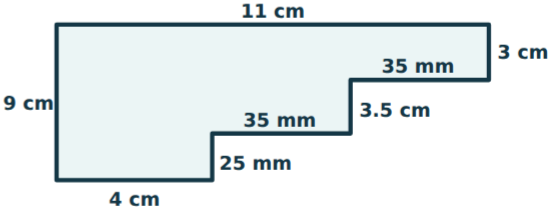


Find the perimeter in centimetres.

**P = _____ cm**

Working:

**Extra working space**