YEAR 6 · GEOMETRY

Nets of 3D Shapes

Name _____ **Date** _____

Look at each net. Write the solid it will make. If it will not fold to make a closed solid, write **not a net**. Use: cube, cuboid, square-based pyramid or triangular prism.

1 **Net**

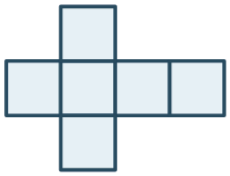

Makes: _____

2 **Net**

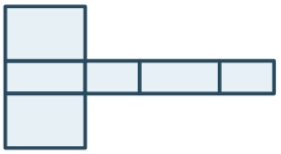

Makes: _____

3 **Net**

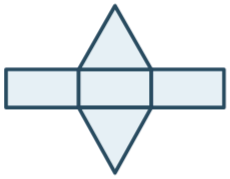

Makes: _____

4 **Net**



Makes: _____

5 **Net**

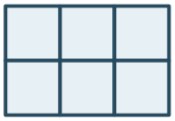

Makes: _____

6 **Net**



Makes: _____

7 **Net**



Makes: _____

8 **Net**

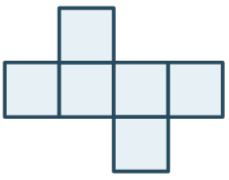

Makes: _____

SHOW YOUR THINKING

Choose one diagram and explain how you know whether it will fold into a closed solid.

_____

_____