YEAR 4 · GEOMETRY

Drawing Lines of Symmetry

Explore how many ways each shape can be folded into matching halves.

Name: _____ Date: _____

Draw every line of symmetry on each shape. Then write the number of lines in the box.

1 Square



Lines of symmetry ☐

2 Rectangle



Lines of symmetry ☐

3 Equilateral triangle

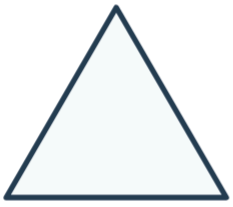

Lines of symmetry ☐

4 Isosceles triangle

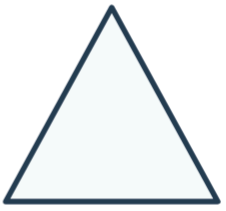

Lines of symmetry ☐

5 Regular pentagon

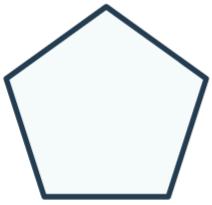

Lines of symmetry ☐

6 Parallelogram



Lines of symmetry ☐

THINK ABOUT THE SHAPES

Which shape has the greatest number of lines of symmetry? _____