MATHS · SHAPE

Drawing and Completing 2D Shapes

Use the grid to help you draw and finish each shape.

Name: _____ **Date:** _____

Use a sharp pencil and draw straight lines. Follow the grid lines where you can.

1 Draw the shapes

Draw each shape on its grid.

Square



Triangle



Rectangle



2 Complete the shapes

Draw the missing side or sides on each grid.

Complete the square

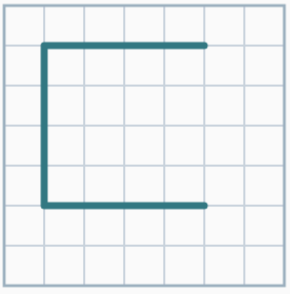

Complete the triangle

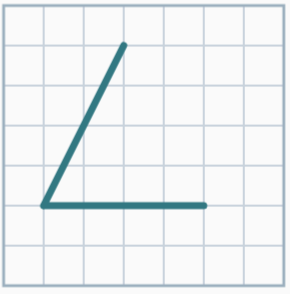

3 Your shape challenge



Draw a 2D shape with four straight sides. Then write its name.

It is a: _____

Check your work: ☐ My lines are straight. ☐ I finished each shape.