MATHS • YEAR 2

# Counting Sides and Corners

**Name:** _____ **Date:** _____

**1** For each 2D shape, count the straight sides and corners. Write one number in each box.

## A Shape A

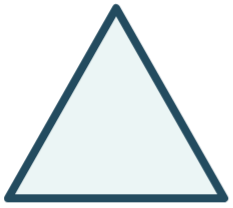

**Sides** ☐

**Corners** ☐

## B Shape B



**Sides** ☐

**Corners** ☐

## C Shape C



**Sides** ☐

**Corners** ☐

## D Shape D

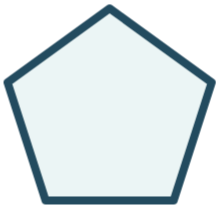

**Sides** ☐

**Corners** ☐

## E Shape E

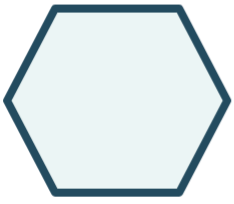

**Sides** ☐

**Corners** ☐

## F Shape F

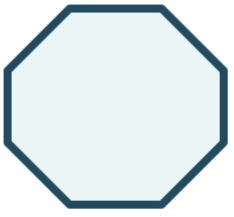

**Sides** ☐

**Corners** ☐

### Think about it

Which two shapes have the same number of sides?

**Letters:** _____

Which shape has the most corners?

**Shape:** _____

### Your turn

Draw a shape with 4 straight sides and 4 corners.

- Before you finish, check that you have counted each corner once.