Identify and Name 2D Shapes

Geometry – Year 4

Name: _____ Date: _____

Use the shape names below to identify and label each shape.

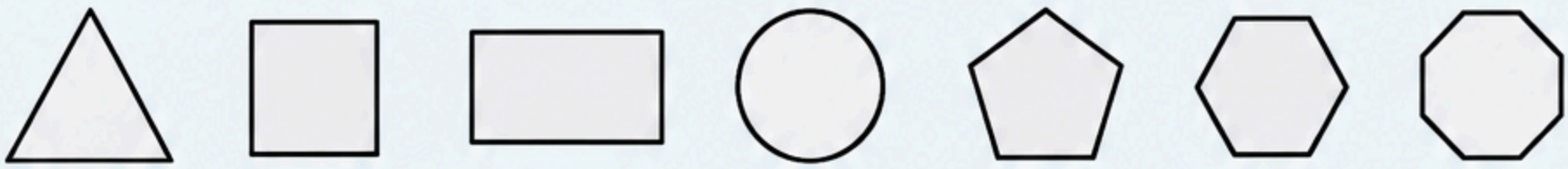

triangle square rectangle circle pentagon hexagon octagon

1. Look at the shapes below. Write the name of each shape in the space provided.

1.

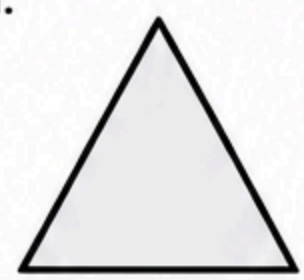

_____

2.



_____

3.



_____

4.



_____

5.



_____

6.

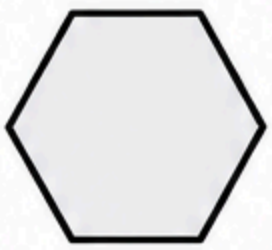

_____

7.



_____

8.

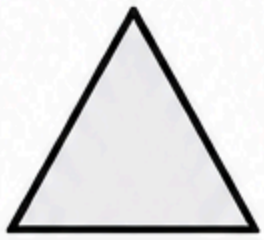

_____

9.



_____

10.



_____

11.



_____

12.



_____

13.

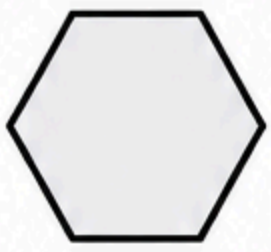

_____

14.



_____

15.

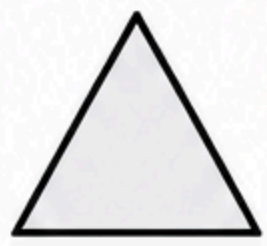

_____