Reading Scales and Measuring Instruments

Measurement – Year 4

Name: _____ Date: _____

1. Read the rulers

Look at each ruler and write the length of the object in centimetres (cm).

a)

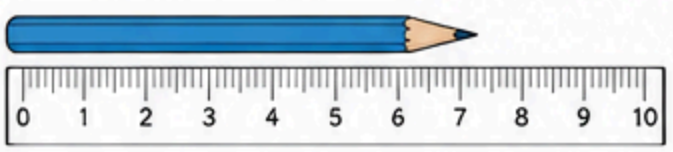

_____ cm

b)



_____ cm

c)



_____ cm

d)

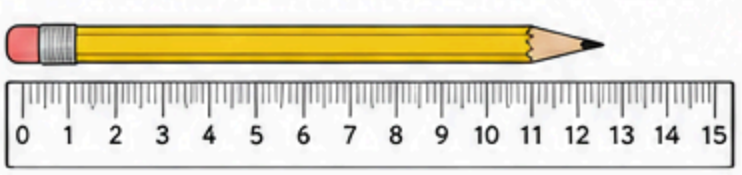

_____ cm

2. Read the measuring jugs

Look at each jug and write the amount of liquid in milliitires (ml).

a)



_____ ml

b)



_____ ml

c)



_____ ml

d)

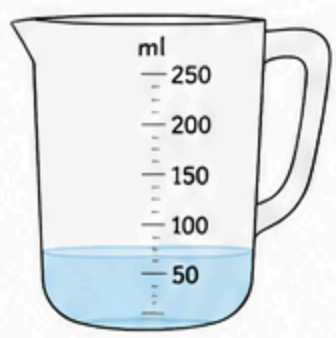

_____ ml

3. Read the thermometers

Look at each thermometer and write the temperature in degrees Celsius (°C).

a) °C

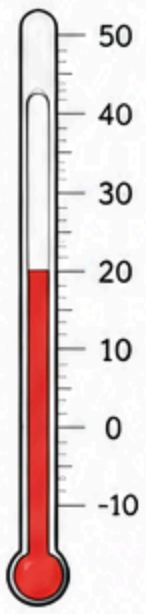

_____ °C

b) °C

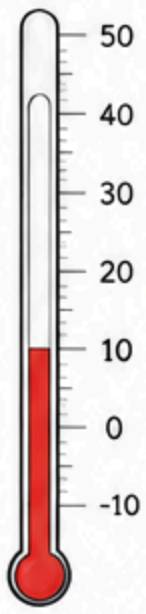

_____ °C

c) °C



_____ °C

d) °C

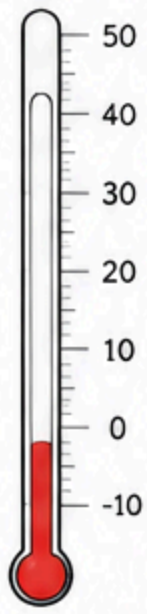

_____ °C

4. Read the weighing scales

Look at each scale and write the mass in grams (g).

a)



_____ g

b)



_____ g

c)



_____ g

d)



_____ g